Która jest godzina, a która będzie? Oblicz godziny. Zapisz je i zaznacz na zegarach.



Jest godzina 13.00.
Która godzina będzie za 60 minut?

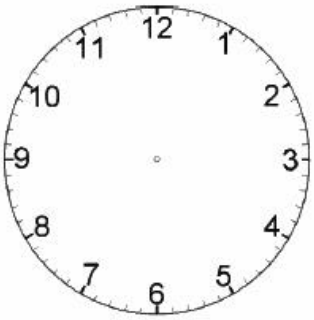

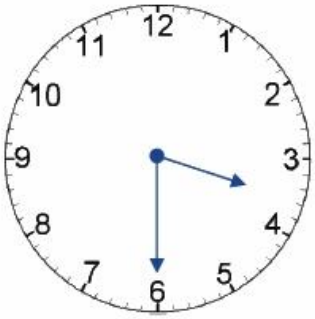

Jest godzina 15.30.
Która godzina będzie za 15 minut?

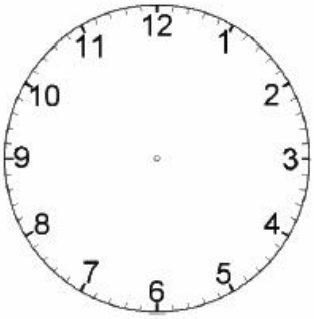

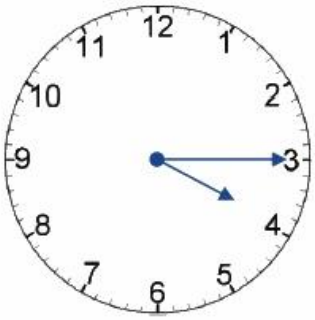

Jest godzina 16.15.
Która godzina będzie za kwadrans?

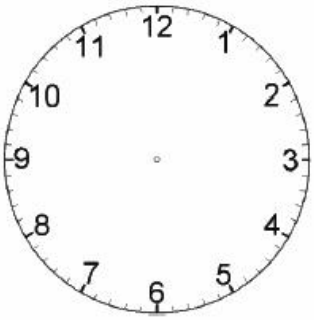

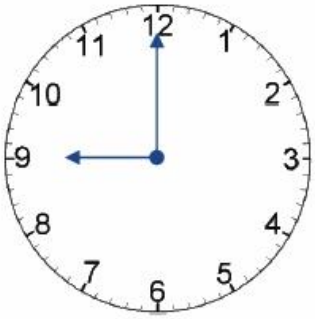

Jest godzina 21.00.
Która godzina będzie za 30 minut?

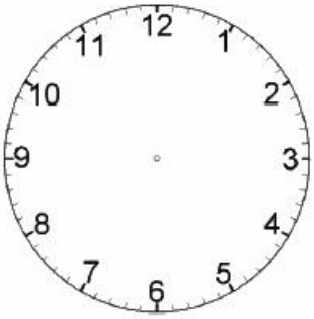

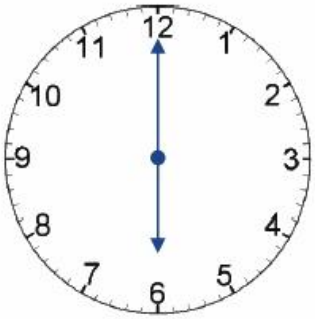
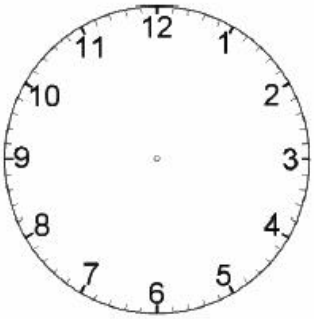
Jest godzina 18.00.
Która godzina będzie za pół godziny?