MATEMATYKA - KARTA POWTÓRZENIOWA nr2

Poznaję czworokaty – kąt prosty.

1. Pokoloruj na zielono wszystkie czworokaty.

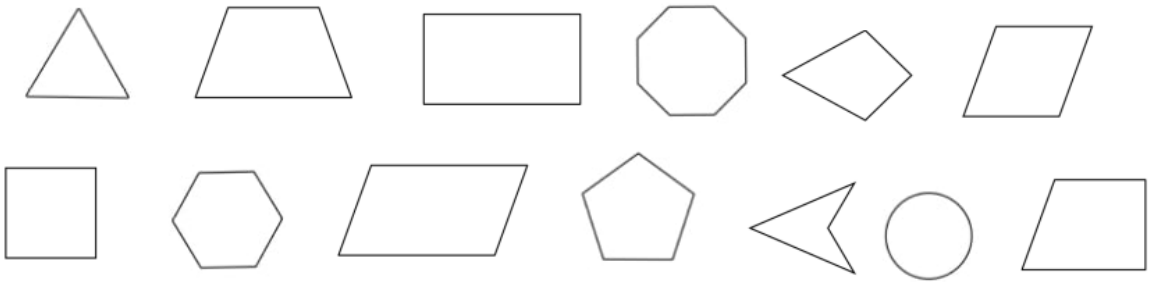

2. Zgodnie z podanymi niżej rysunkami zaznacz w figurach wszystkie kąty proste. Możesz użyć do tego ćwiczenia ekierki.

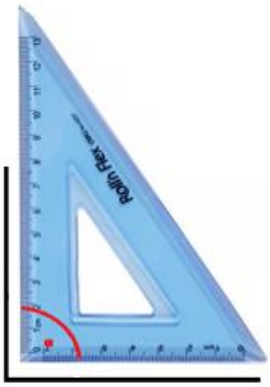

a)



b)



c)

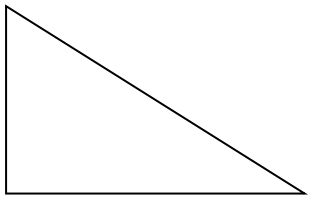

d)

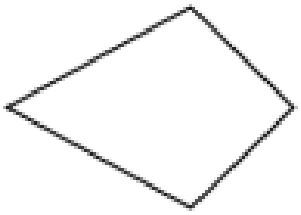
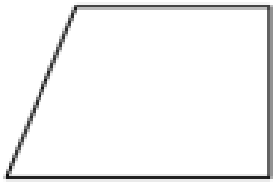
e)