Porównaj liczebność elementów, wpisz odpowiednie cyfry pod zbiorami i wpisz odpowiedni znak > = <

Powiedz, o ile więcej jest w danym zbiorze?







Wpisz odpowiednie cyfry pod obrazkami. Porównaj czego jest więcej, wpisz odpowiedni znak > = <

Powiedz o ile więcej jest elementów.









Wpisz odpowiednie cyfry pod obrazkami. Porównaj czego jest więcej, wpisz odpowiedni znak > = <

Powiedz o ile więcej jest elementów.



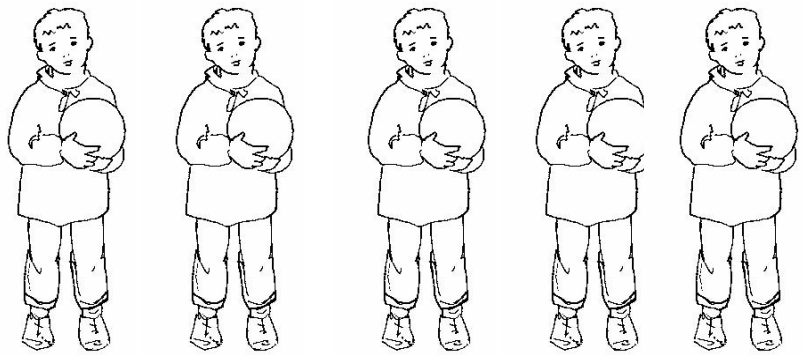





Wpisz odpowiednie cyfry pod obrazkami. Porównaj czego jest więcej, wpisz odpowiedni znak > = <
Powiedz o ile więcej jest elementów.

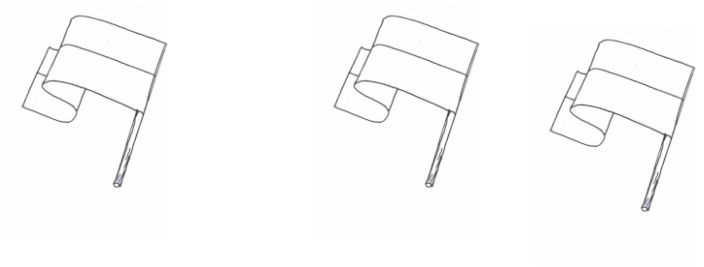

……. ……. …….





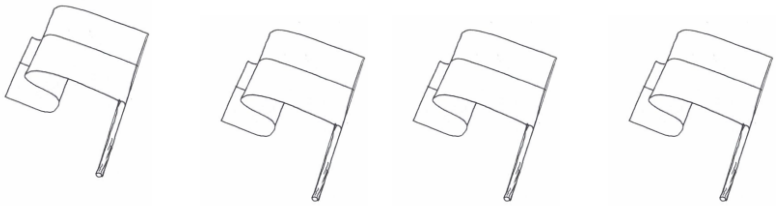

……. …… …….

Wpisz odpowiednie cyfry pod obrazkami. Porównaj czego jest więcej, wpisz odpowiedni znak > = <
Powiedz o ile więcej jest elementów.

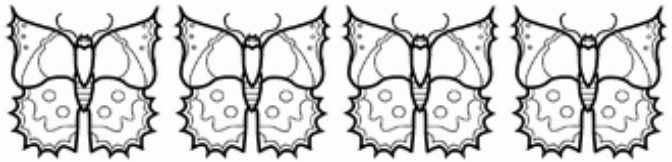

…….. ……

……

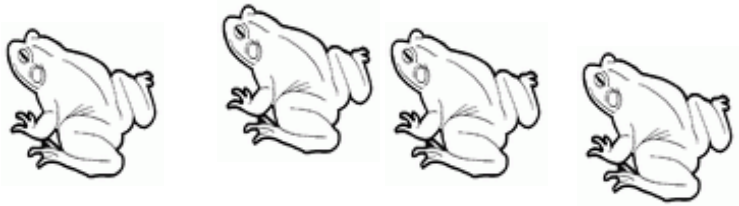

…….. ……. …….



…… …… …….