Tabliczka mnożenia i dzielenia w zakresie 30 - Mnożenie przez 4

Pies ma 4 łapy. Oblicz, ile łap mają:

2 psy

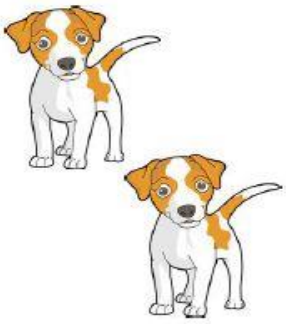

3 psy

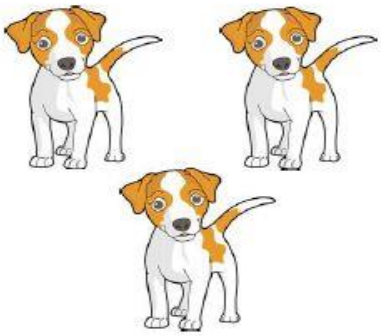

4 psy

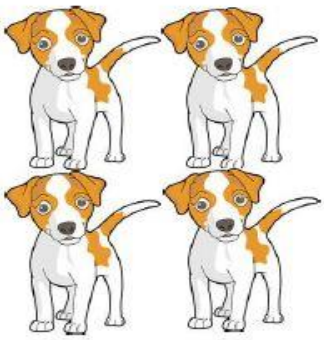

4 + 4 = ...

2 • 4 = ...

4 + 4 + 4 = ...

3 • 4 = ...

4 + ...

.....

Oblicz.

1 • 4 = ...

4 • 4 = ...

0 • 4 = ...

5 • 4 = ...

6 • 4 = ...

2 • 4 = ...

7 • 4 = ...

3 • 4 = ...

8 • 4 = ...

Oblicz, ile jest czerwonych owoców?

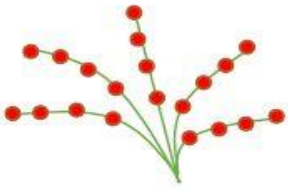

4 + ...

.....•.....=.....

str. 2

Wklej kartkę do zeszytu.

Wykonaj obliczenia.

$6 \cdot 2 =$	$6 + 2 =$	$6 - 2 =$
$5 \cdot 3 =$	$5 + 3 =$	$5 - 3 =$
$4 \cdot 4 =$	$4 + 4 =$	$4 - 4 =$
$9 \cdot 2 =$	$9 + 2 =$	$9 - 2 =$
$4 \cdot 3 =$	$4 + 3 =$	$4 - 3 =$
$6 \cdot 3 =$	$6 + 3 =$	$6 - 3 =$

Oblicz, ile klocków użyto do wykonania każdej budowli.