1 Dokończ według wzoru.

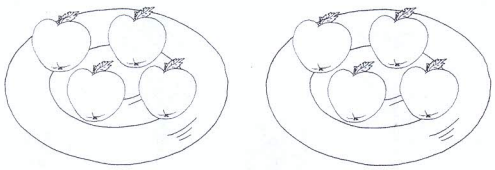

$4 + 4 = \square \qquad \square \cdot 4 = \square$

$2 + 2 + 2 + 2 = \square \qquad \square \cdot 2 = \square$

$3 + 3 + 3 = \square \qquad \square \cdot 3 = \square$

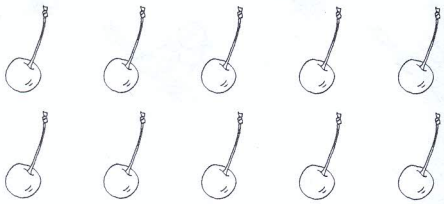

$5 + 5 = \square \qquad \square \cdot 5 = \square$



$2 + 2 + 2 + 2 + 2 = \square \qquad \square \cdot 2 = \square$

4 s. 16
w. 138

2 Oblicz i pokoloruj zgodnie ze wskazówkami nauczyciela.



ZGODA